Honors Math II
Unit 9 day 7

Name_____
Period_____Date_____

1. Determine an equation for this graph:

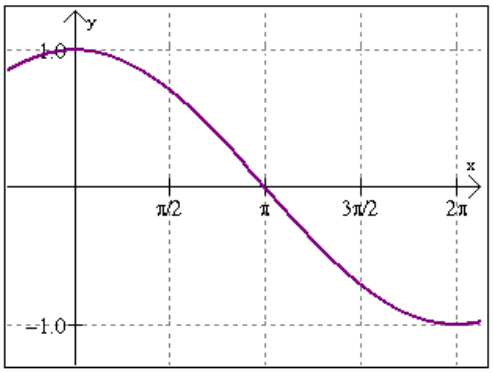

Choose:

- $y = \cos(2x)$
- $y = 2\cos(x)$
- $y = \frac{1}{2}\cos(x)$
- $y = \cos\left(\frac{1}{2}x\right)$

2. Determine an equation for this graph:

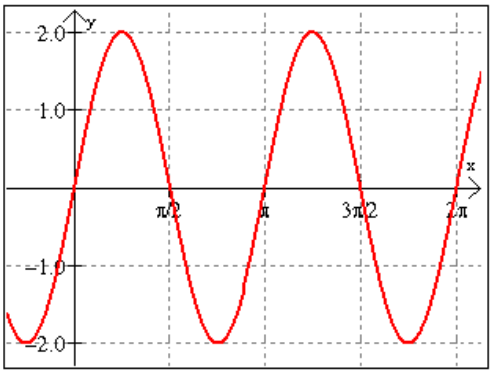

Choose:

- $y = 2\sin\left(\frac{1}{2}x\right)$
- $y = 2\sin(2x)$
- $y = 2\cos\left(\frac{1}{2}x\right)$
- $y = 2\cos(2x)$

3. Determine an equation for this graph:

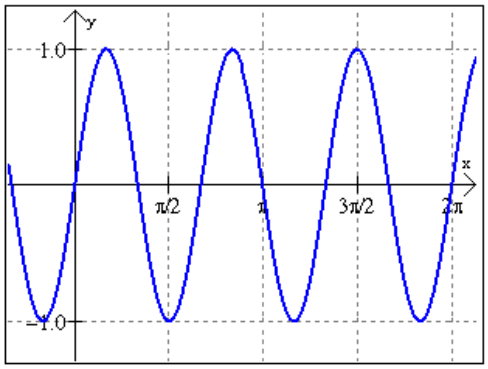

Choose:

- $y = 3\sin(x)$
- $y = 3\sin(3x)$
- $y = \sin(3x)$
- $y = \sin\left(\frac{1}{3}x\right)$

4. Determine an equation for this graph:

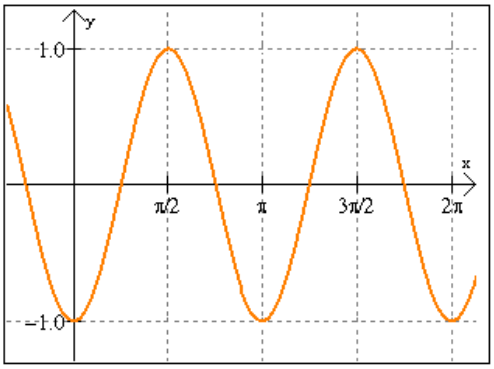

Choose:

- $y = -\cos(2x)$
- $y = -\cos\left(\frac{1}{2}x\right)$
- $y = -\sin(2x)$
- $y = -2\cos\left(\frac{1}{2}x\right)$

Write the equation for the given graphs. (There is no horizontal phase shift)

5.

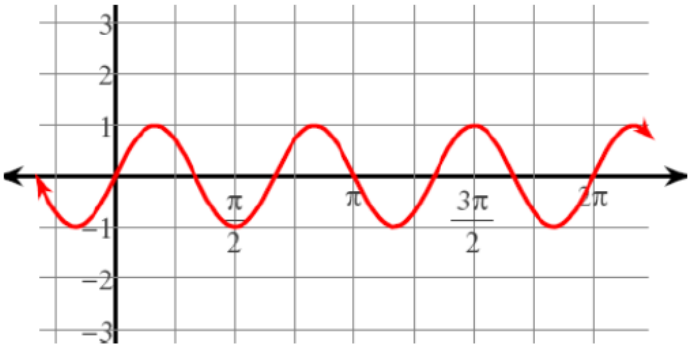

6.

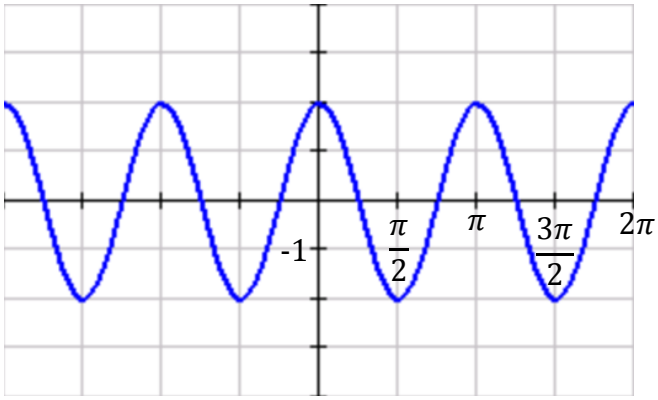

7.

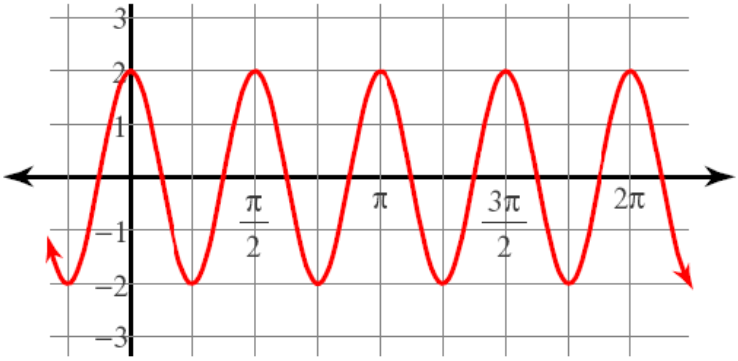

8.

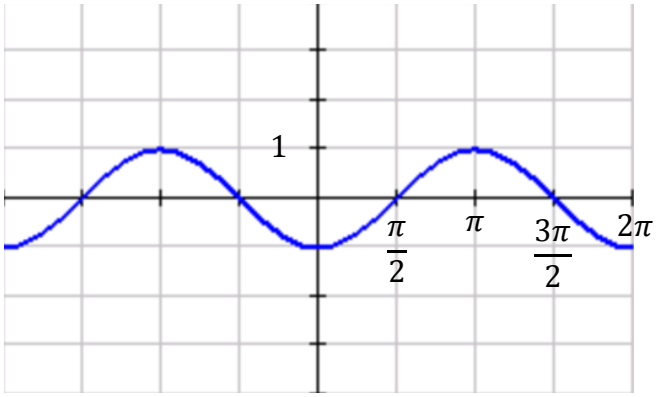

Graph each function using radians.

15. $y = 4cos\theta$

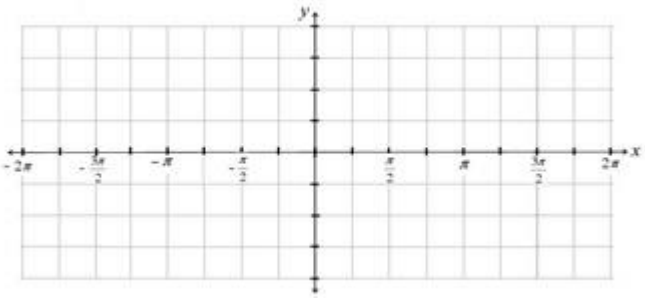

16. $y = -3cos\theta$

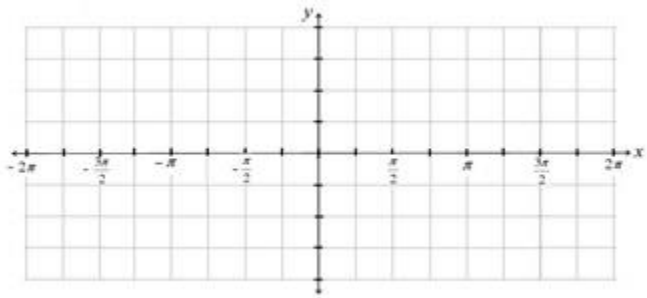

19. $y = 4cos2x$

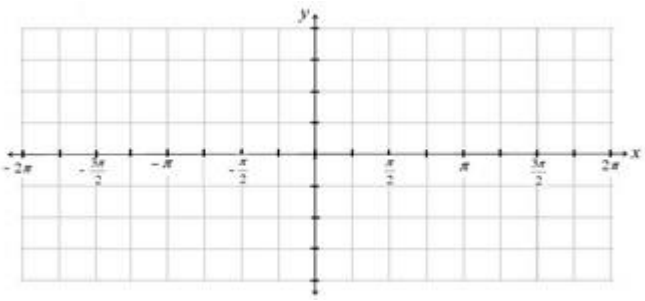

20. $y = -2cos\frac{\theta}{2}$

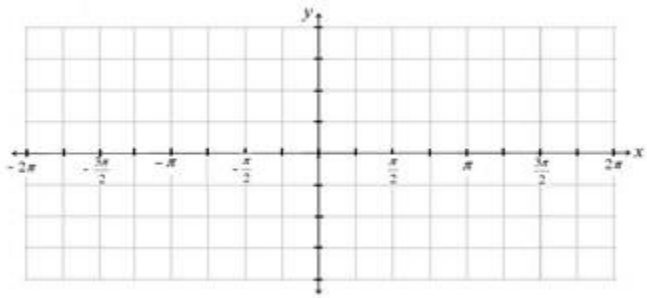

21. $y = cos\left(\theta + \frac{\pi}{2}\right)$

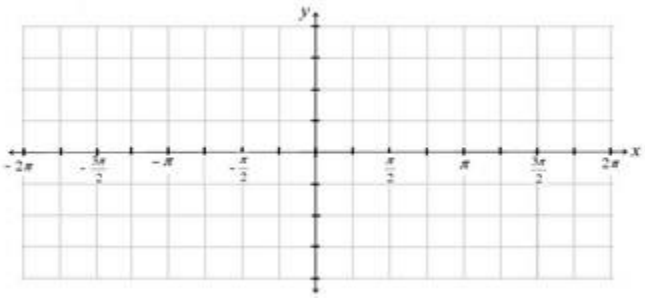

22. $y = -3\cos\left(x - \frac{\pi}{4}\right)$

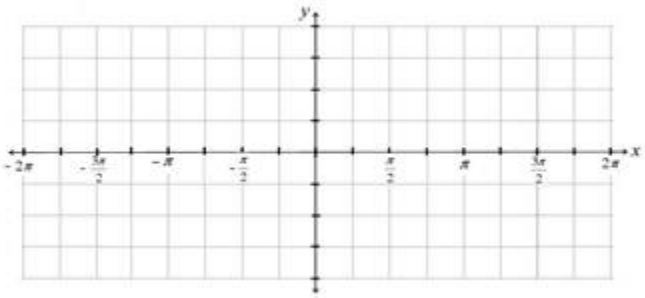

23. $y = 2cosx + 2$

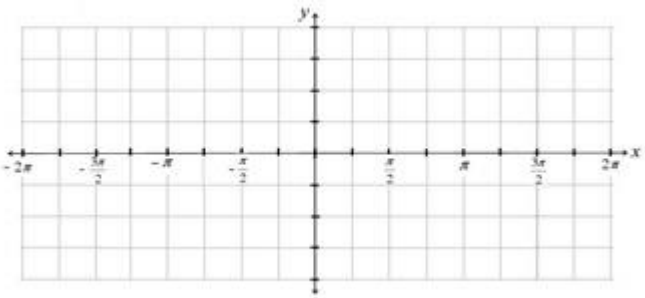

24. $y = 3cos\left(\theta + \frac{\pi}{2}\right) - 1$

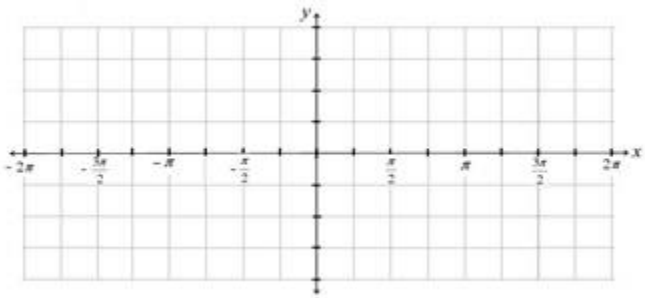

25. $y = -cos\left(\theta + \frac{\pi}{2}\right) + 1$

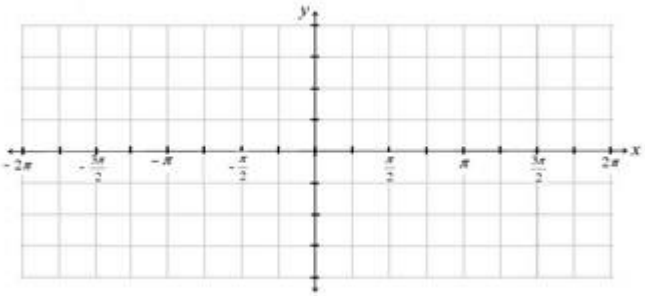

26. $y = -sin(x + \pi) + 2$

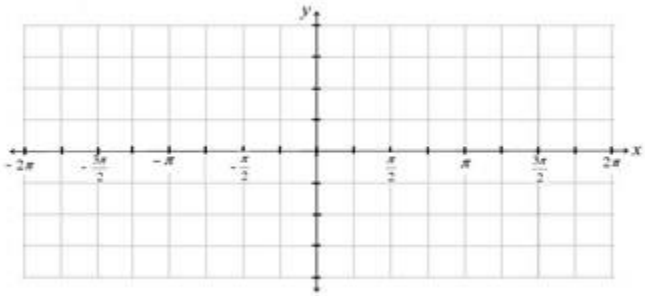

27. $y = 4sin\left(x + \frac{5\pi}{4}\right) - 1$

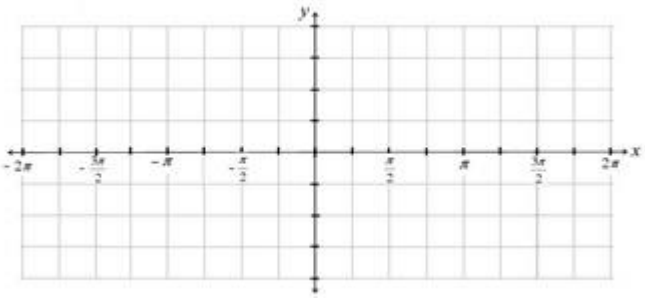
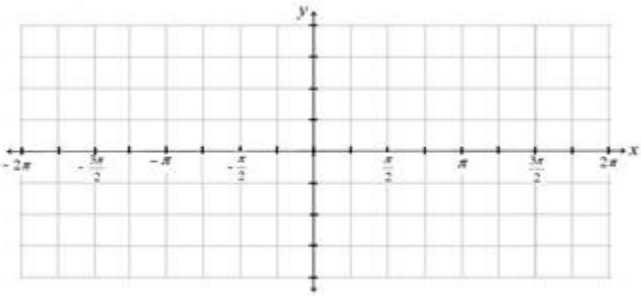
28. $y = 3\cos\left(x + \frac{3\pi}{4}\right) - 2$